www.mymathscloud.com
My Maths Cloud

Cambridge International AS & A Level

Cambridge International Examinations
Cambridge International Advanced Subsidiary and Advanced Level

CANDIDATE NAME	

CENTRE NUMBER						CANDIDATE NUMBER				

7125996237

MATHEMATICS **9709/11**

Paper 1 Pure Mathematics 1 **(P1)** **October/November 2017**

1 hour 45 minutes

Candidates answer on the Question Paper.

Additional Materials: List of Formulae (MF9)

READ THESE INSTRUCTIONS FIRST

Write your Centre number, candidate number and name in the spaces at the top of this page.
Write in dark blue or black pen.
You may use an HB pencil for any diagrams or graphs.
Do not use staples, paper clips, glue or correction fluid.
DO **NOT** WRITE IN ANY BARCODES.

Answer **all** the questions.
Give non-exact numerical answers correct to 3 significant figures, or 1 decimal place in the case of angles in degrees, unless a different level of accuracy is specified in the question.
The use of an electronic calculator is expected, where appropriate.
You are reminded of the need for clear presentation in your answers.

At the end of the examination, fasten all your work securely together.
The number of marks is given in brackets [ ] at the end of each question or part question.
The total number of marks for this paper is 75.

This document consists of **19** printed pages and **1** blank page.

© UCLES 2017

www.mymathscloud.com
My Maths Cloud

1 A curve has equation $y = 2x^{\frac{3}{2}} - 3x - 4x^{\frac{1}{2}} + 4$. Find the equation of the tangent to the curve at the point $(4, 0)$. [4]

www.mymathscloud.com
My Maths Cloud

2 A function f is defined by $f : x \mapsto x^3 - x^2 - 8x + 5$ for $x < a$. It is given that f is an increasing function. Find the largest possible value of the constant a. [4]

www.mymathscloud.com
My Maths Cloud

3 **(a)** A geometric progression has first term $3a$ and common ratio r. A second geometric progression has first term a and common ratio $-2r$. The two progressions have the same sum to infinity. Find the value of r. [3]

www.mymathscloud.com
My Maths Cloud

(b) The first two terms of an arithmetic progression are 15 and 19 respectively. The first two terms of a second arithmetic progression are 420 and 415 respectively. The two progressions have the same sum of the first n terms. Find the value of n. [3]

www.mymathscloud.com
My Maths Cloud

4 Machines in a factory make cardboard cones of base radius r cm and vertical height h cm. The volume, V cm^3, of such a cone is given by $V = \frac{1}{3}\pi r^2 h$. The machines produce cones for which $h + r = 18$.

(i) Show that $V = 6\pi r^2 - \frac{1}{3}\pi r^3$. [1]

.....

.....

.....

.....

.....

.....

.....

(ii) Given that r can vary, find the non-zero value of r for which V has a stationary value and show that the stationary value is a maximum. [4]

.....

.....

.....

.....

.....

.....

.....

.....

.....

.....

.....

.....

.....

.....

.....

www.mymathscloud.com
My Maths Cloud

.....

.....

.....

.....

.....

.....

.....

.....

.....

.....

.....

.....

.....

.....

(iii) Find the maximum volume of a cone that can be made by these machines. [1]

.....

.....

.....

.....

.....

.....

.....

.....

.....

.....

.....

www.mymathscloud.com
My Maths Cloud

5

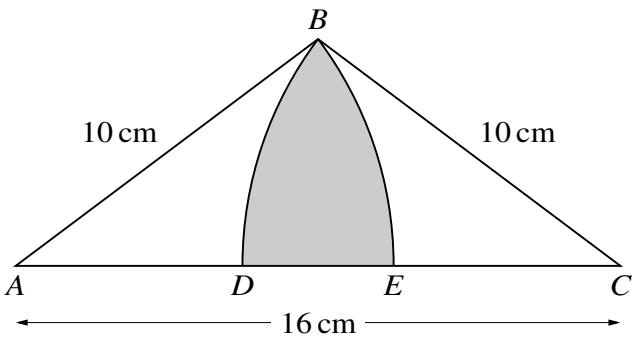

The diagram shows an isosceles triangle ABC in which $AC = 16$ cm and $AB = BC = 10$ cm. The circular arcs BE and BD have centres at A and C respectively, where D and E lie on AC.

(i) Show that angle $BAC = 0.6435$ radians, correct to 4 decimal places. [1]

.....

.....

.....

.....

.....

.....

.....

.....

.....

.....

(ii) Find the area of the shaded region. [5]

.....

.....

.....

.....

.....

.....

.....

www.mymathscloud.com
My Maths Cloud

www.mymathscloud.com
My Maths Cloud

6 The points $A\,(1,\ 1)$ and $B\,(5,\ 9)$ lie on the curve $6y = 5x^2 - 18x + 19$.

(i) Show that the equation of the perpendicular bisector of AB is $2y = 13 - x$. [4]

www.mymathscloud.com
My Maths Cloud

The perpendicular bisector of AB meets the curve at C and D.

(ii) Find, by calculation, the distance CD, giving your answer in the form $\sqrt{\left(\frac{p}{q}\right)}$, where p and q are integers. [5]

www.mymathscloud.com
My Maths Cloud

7 **(a)**

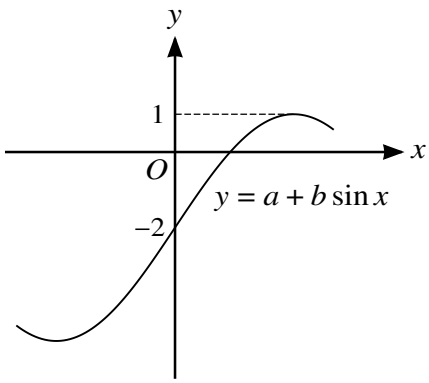

The diagram shows part of the graph of $y = a + b\sin x$. Find the values of the constants a and b. [2]

.....

.....

.....

.....

.....

.....

.....

.....

.....

.....

.....

.....

.....

.....

.....

.....

.....

.....

www.mymathscloud.com
My Maths Cloud

(b) **(i)** Show that the equation

$$(\sin\theta + 2\cos\theta)(1 + \sin\theta - \cos\theta) = \sin\theta(1 + \cos\theta)$$

may be expressed as $3\cos^2\theta - 2\cos\theta - 1 = 0$. [3]

.....

.....

.....

.....

.....

.....

.....

.....

.....

.....

(ii) Hence solve the equation

$$(\sin\theta + 2\cos\theta)(1 + \sin\theta - \cos\theta) = \sin\theta(1 + \cos\theta)$$

for $-180° \leqslant \theta \leqslant 180°$. [4]

.....

.....

.....

.....

.....

.....

.....

.....

.....

.....

.....

www.mymathscloud.com
My Maths Cloud

8 **(a)** Relative to an origin O, the position vectors of two points P and Q are $\mathbf{p}$ and $\mathbf{q}$ respectively. The point R is such that PQR is a straight line with Q the mid-point of PR. Find the position vector of R in terms of $\mathbf{p}$ and $\mathbf{q}$, simplifying your answer. [3]

www.mymathscloud.com
My Maths Cloud

(b) The vector $6\mathbf{i} + a\mathbf{j} + b\mathbf{k}$ has magnitude 21 and is perpendicular to $3\mathbf{i} + 2\mathbf{j} + 2\mathbf{k}$. Find the possible values of a and b, showing all necessary working. [6]

www.mymathscloud.com
My Maths Cloud

9 Functions f and g are defined for $x > 3$ by

$$\mathrm{f} : x \mapsto \frac{1}{x^2 - 9},$$
$$\mathrm{g} : x \mapsto 2x - 3.$$

(i) Find and simplify an expression for $\mathrm{gg}(x)$. [2]

.....

.....

.....

.....

.....

.....

.....

.....

.....

(ii) Find an expression for $\mathrm{f}^{-1}(x)$ and state the domain of f^{-1}. [4]

.....

.....

.....

.....

.....

.....

.....

.....

.....

.....

.....

.....

www.mymathscloud.com
My Maths Cloud

.....

.....

.....

.....

.....

.....

.....

.....

(iii) Solve the equation $\mathrm{fg}(x) = \frac{1}{7}$. [4]

.....

.....

.....

.....

.....

.....

.....

.....

.....

.....

.....

.....

.....

.....

.....

.....

www.mymathscloud.com
My Maths Cloud

10

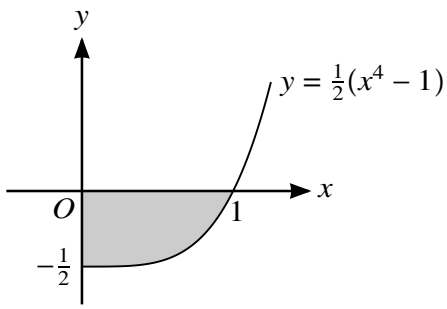

The diagram shows part of the curve $y = \frac{1}{2}(x^4 - 1)$, defined for $x \geqslant 0$.

(i) Find, showing all necessary working, the area of the shaded region. [3]

.....

.....

.....

.....

.....

.....

.....

.....

(ii) Find, showing all necessary working, the volume obtained when the shaded region is rotated through 360° about the x-axis. [4]

.....

.....

.....

.....

.....

.....

.....

.....

.....

www.mymathscloud.com
My Maths Cloud

.....

.....

.....

.....

.....

.....

.....

.....

(iii) Find, showing all necessary working, the volume obtained when the shaded region is rotated through 360° about the y-axis. [5]

.....

.....

.....

.....

.....

.....

.....

.....

.....

.....

.....

.....

.....

.....

.....

.....

BLANK PAGE

www.mymathscloud.com
My Maths Cloud

Permission to reproduce items where third-party owned material protected by copyright is included has been sought and cleared where possible. Every reasonable effort has been made by the publisher (UCLES) to trace copyright holders, but if any items requiring clearance have unwittingly been included, the publisher will be pleased to make amends at the earliest possible opportunity.

To avoid the issue of disclosure of answer-related information to candidates, all copyright acknowledgements are reproduced online in the Cambridge International Examinations Copyright Acknowledgements Booklet. This is produced for each series of examinations and is freely available to download at www.cie.org.uk after the live examination series.

Cambridge International Examinations is part of the Cambridge Assessment Group. Cambridge Assessment is the brand name of University of Cambridge Local Examinations Syndicate (UCLES), which is itself a department of the University of Cambridge.

© UCLES 2017